What's Next? Picture Sequences

Write 1, 2 and 3 under the pictures to show each sequence in order.

Name: _____ **Date:** _____

SEQUENCE 1



FLOWER ○



SEED ○



SPROUT ○

SEQUENCE 2

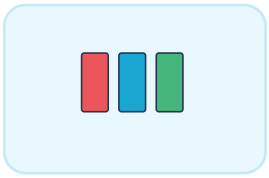

3 BLOCKS ○

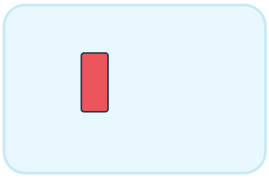

1 BLOCK ○

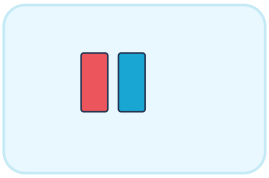

2 BLOCKS ○

SEQUENCE 3

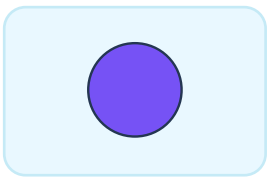

LARGE ○



SMALL ○

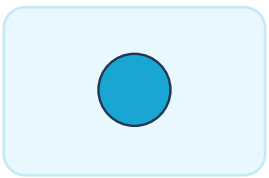

MEDIUM ○

Explain one answer: First ___, next ___, last ___.

The plant grows from a seed to a sprout to a flower. For the other rows, put amounts or sizes in order.